Multiple Choice Answer

Score: _____

Date: _____

Name: _____

© Copyright 2000-2011 Math Fact Cafe, LLC
All rights reserved.

Count the value of all coins. Circle the total amount.

1)	21¢	36¢	26¢	41¢
2)	50¢	45¢	35¢	55¢
3)	35¢	25¢	30¢	45¢
4)	20¢	30¢	25¢	15¢
5)	30¢	20¢	15¢	25¢
6) 	66¢	61¢	41¢	51¢
7)	22¢	12¢	27¢	17¢
8)	55¢	50¢	45¢	60¢
9) 	46¢	36¢	31¢	41¢
10)	2¢	7¢	12¢	17¢
11) 	27¢	32¢	37¢	17¢
12)	35¢	40¢	20¢	30¢